WEEKLY REVIEW 4~5

SEPTEMBER 18TH~27TH 2024

3D

Name: _____.

CLASS LINKS

RENAISSANCE
myON

epic!

BRAINZ!?

Class Code: xge5413

WEEKLY REVIEW: 4~5 (SEPTEMBER 18TH ~27TH)

WEDNESDAY

NAME:

New Vocabulary Words		
record **experience**	**community** **memory**	**equation** **model**

Use a dictionary, or the Dictionary/Translate app on your iPad, find the meaning of the new vocabulary words. Then, write a good sentence using that word correctly.

Word	Meaning
E.g.: disaster	When something bad happens. *It was a disaster when the cake fell on the floor.*
record	
experience	
community	
memory	
equation	
model	

Quick Maths



Math Homework Book: Lesson 10

3D

WEEKLY REVIEW: 4~5 (SEPTEMBER 18TH ~27TH)

WEDNESDAY

TITANS



WEEKLY REVIEW: 4~5 (SEPTEMBER 18TH ~27TH)

THURSDAY

NAME:

Can you remember last weekend? Write down what you did on the long weekend. Make sure to use the PAST TENSE in your retell.

Quick Maths



Math Homework Book: Lesson 11

3D

WEEKLY REVIEW: 4~5 (SEPTEMBER 18TH ~27TH)

THURSDAY THE INCREDIBLES

WEEKLY REVIEW: 4~5 (SEPTEMBER 18TH ~27TH)

FRIDAY

NAME:

Choose one of the FICTION books you have read for your home reading.

1. What is the title of the book?

_____

_____

2. Who was the main character?

_____

_____

3. What was the setting of the story?

_____

_____

4. What is the moral of the story?

_____

_____

5. Was the story interesting? Why?

_____

_____

_____

_____

Quick Maths

Mr Chad. has 30 pencils and 5 students. He gives each student equal number of pencils. Use RDW to show much each student gets.

3D

WEEKLY REVIEW: 4~5 (SEPTEMBER 18TH ~27TH)

FRIDAY

POWER RANGERS

WEEKLY REVIEW: 4~5 (SEPTEMBER 18TH ~27TH)

WEEKEND

NAME:

Fernando puts 3 pictures on each page of his photo album. He puts pictures on 8 pages.

a. Use circles to draw an array that represents the total number of pictures in Fernando's photo album.

b. Use your array to write and solve a multiplication sentence to find Fernando's total number of pictures.

c. Fernando adds 2 more pages to his book. He puts 3 pictures on each new page. Draw x's to show the new pictures on the array in Part (a).

d. Write and solve a multiplication sentence to find the new total number of pictures in Fernando's album.

Ivania recycles. She gets 3 cents for every can she recycles.

a. How much money does Ivania make if she recycles 4 cans?

_____ × _____ = _____ cents

b. How much money does Ivania make if she recycles 7 cans?

_____ × _____ = _____ cents

WEEKLY REVIEW: 4~5 (SEPTEMBER 18TH ~27TH)

WEEKEND

X-MEN

WEEKLY REVIEW: 4~5 (SEPTEMBER 18TH ~27TH)

MONDAY

NAME:

Fill in the blanks with correct answers.

1. Amieza _____ (play) badminton yesterday.
2. Azri _____ (jump) up very high.
3. Umairah _____ (cry) last night.
4. Azam _____ (look) for shells yesterday evening.
5. Fatihah _____ (live) in Malacca last year.
6. Zamer _____ (do) his homework last night.
7. Aziha _____ (eat) Nasi Lemak this morning.
8. Iman _____ (take) her family photo last month.
9. Zurina _____ (go) to Sarawak two days ago.
10. Elisa _____ (listen) to music yesterday morning.
11. Naim _____ (get) a new bike last year.
12. Mariam _____ (watch) Korean movies last night.
13. Najmi _____ (sing) her favourite song.
14. Atiqah _____ (bake) a chocolate cake yesterday.
15. Umar _____ (swim) with his friends this afternoon.

played
jumped
ate
took
looked
listened
went
lived
watched
sang
baked
swam
got
did
cried

Quick Maths



Math Homework Book:
Lesson 13

WEEKLY REVIEW: 4~5 (SEPTEMBER 18TH ~27TH)

MONDAY

WEEKLY REVIEW: 4~5 (SEPTEMBER 18TH ~27TH)

TUESDAY

NAME:

Some verbs form their past tense with a completely different word.

wake – woke
know - knew

Fill in the blanks with the past tense of the verb.

1. The dog (*dig*) _____ a hole in the ground.
2. My friend (*keep*) _____ her promise.
3. She (*think*) _____ about her answer before speaking.
4. The leaves (*fall*) _____ off the trees.
5. The students (*get*) _____ on the bus.
6. They (*ride*) _____ their bicycles.
7. Our guests (*bring*) _____ dessert with them.
8. The girl (*draw*) _____ a rainbow on her sheet.
9. I (*understand*) _____ the question.
10. Your father (*pay*) _____ for our tickets.
11. They (*forgive*) _____ us.
12. Juliet (*find*) _____ her glasses.

Quick Maths

Mr. Bueser writes: 4 x 2 = 2 x 4. Do you agree or disagree? Use RDW to explain why.

3D

WEEKLY REVIEW: 4~5 (SEPTEMBER 18TH ~27TH)

JLA TUESDAY JUSTICE LEAGUE

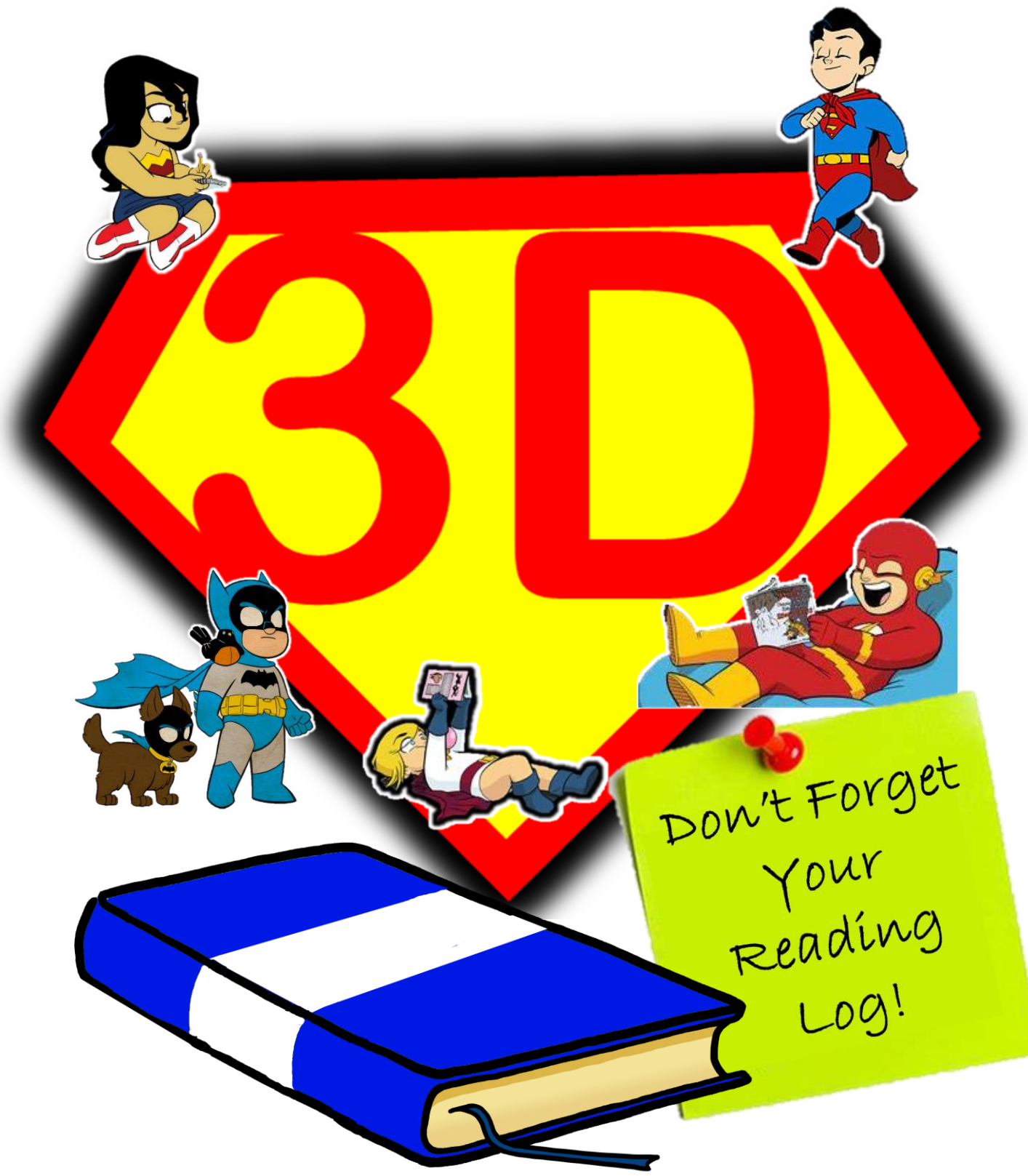

WEEKLY REVIEW: 4~5 (SEPTEMBER 18TH ~27TH)

WEDNESDAY

NAME:

New Vocabulary Words		
reason donate	generate process	strategy fortunate

Use a dictionary, or the Dictionary/Translate app on your iPad, find the meaning of the new vocabulary words. Then, write a good sentence using that word correctly.

Word E.g.: disaster	Meaning When something bad happens. *It was a disaster when the cake fell on the floor.*
reason	
donate	
generate	
process	
strategy	
fortunate	

Quick Maths



Math Homework Book: Lesson 14

3D

WEEKLY REVIEW: 4~5 (SEPTEMBER 18TH ~27TH)

WEDNESDAY

TITANS

WEEKLY REVIEW: 4~5 (SEPTEMBER 18TH ~27TH)

THURSDAY

NAME:

Irregular Past Tense Verbs Cloze

Fill in the blanks below with one of the 15 irregular past tense verbs in the box.

ate	drank	made	read	took
came	gave	met	saw	went
did	got	ran	swam	rode

(1) He _____ his homework before he went to school.

(2) It was cold so we _____ some hot chocolate.

(3) I _____ a sandcastle when I went to the beach.

(4) It was a hot day so she _____ in the lake yesterday.

(5) His car had a flat tire so he _____ the bus to work.

(6) I _____ a horse last summer when I went to my uncle's farm.

(7) I was late for class so I _____ to school.

(8) I _____ two hamburgers so I am full.

(9) I _____ a good book before I went to bed.

(10) She _____ a lion when she went to the zoo.

(11) A letter _____ in the mail today.

(12) They _____ hiking yesterday.

(13) I _____ my brother a game for his birthday.

(14) She _____ a good report card so her mom was happy.

(15) I _____ my friends when we went to the park.

Quick Maths

Mr Chad grows 20 tomatoes. He asks his son Harry, to put them into equal groups of 5 bags. Using RDW, how many tomatoes are in each bag?



WEEKLY REVIEW: 4~5 (SEPTEMBER 18TH ~27TH)

THURSDAY THE INCREDIBLES

WEEKLY REVIEW: 4~5 (SEPTEMBER 18TH ~27TH)

FRIDAY

NAME:

What have you done today? Tell a story about what you have done today (or yesterday).
Make sure to use the PAST TENSE in your retell.

Quick Maths



Math Homework Book: Lesson 16

3D

WEEKLY REVIEW: 4~5 (SEPTEMBER 18TH ~27TH)

FRIDAY

POWER RANGERS

WEEKLY REVIEW: 4~5 (SEPTEMBER 18TH ~27TH)

WEEKEND

NAME:

Adriana organizes her books on shelves. She puts 3 books in each row.

a. Fill in the equations on the right. Use them to draw arrays that show the books on Adriana's top and bottom shelves.

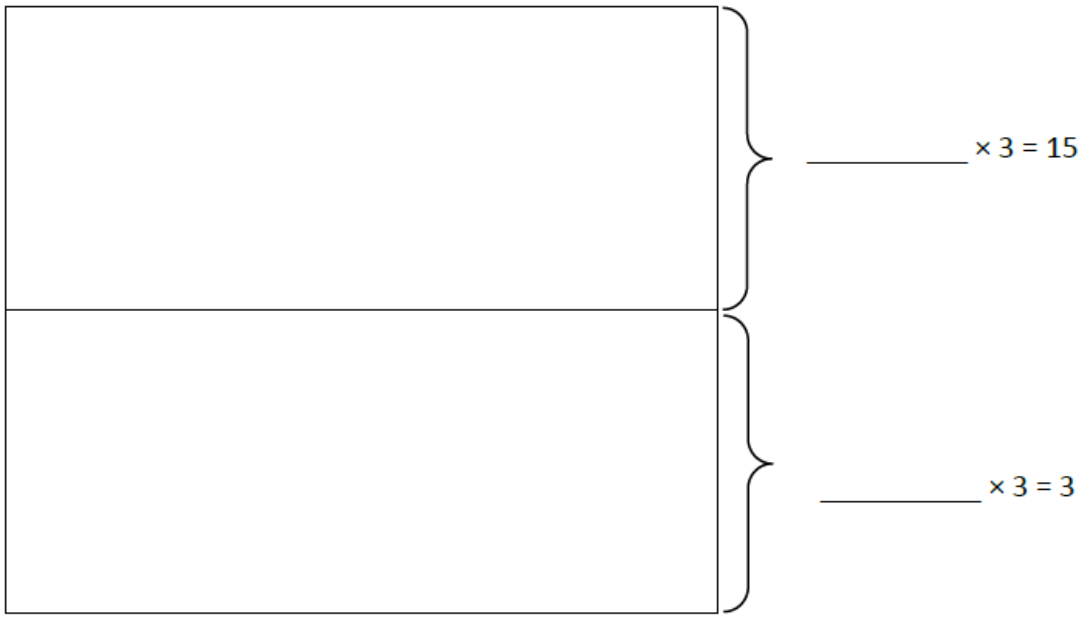

b. Adriana calculates the total number of books as shown below. Use the array you drew to help explain Adriana's calculation.

6 × 3 = 15 + 3 = 18

WEEKLY REVIEW: 4~5 (SEPTEMBER 18TH ~27TH)

WEEKEND

X-MEN

WEEKLY REVIEW: 4~5 (SEPTEMBER 18TH ~27TH)

MONDAY

NAME:

Choose one of the FICTION books you have read for your home reading.

1. What is the title of the book?

_____

_____

2. Who was the main character?

_____

_____

3. What was the setting of the story?

_____

_____

4. What was the genre of the book? (what type of book was it? How do you know?

_____

_____

5. Was the story interesting? Why?

_____

_____

_____

Quick Maths

Mr. Bueser writes: 6x 2 = 2 x 6. Do you agree or disagree?
Use RDW to explain why.

WEEKLY REVIEW: 4~5 (SEPTEMBER 18TH ~27TH)

MONDAY

AVENGERS

Quick Maths



Math Homework Book: Lesson 5

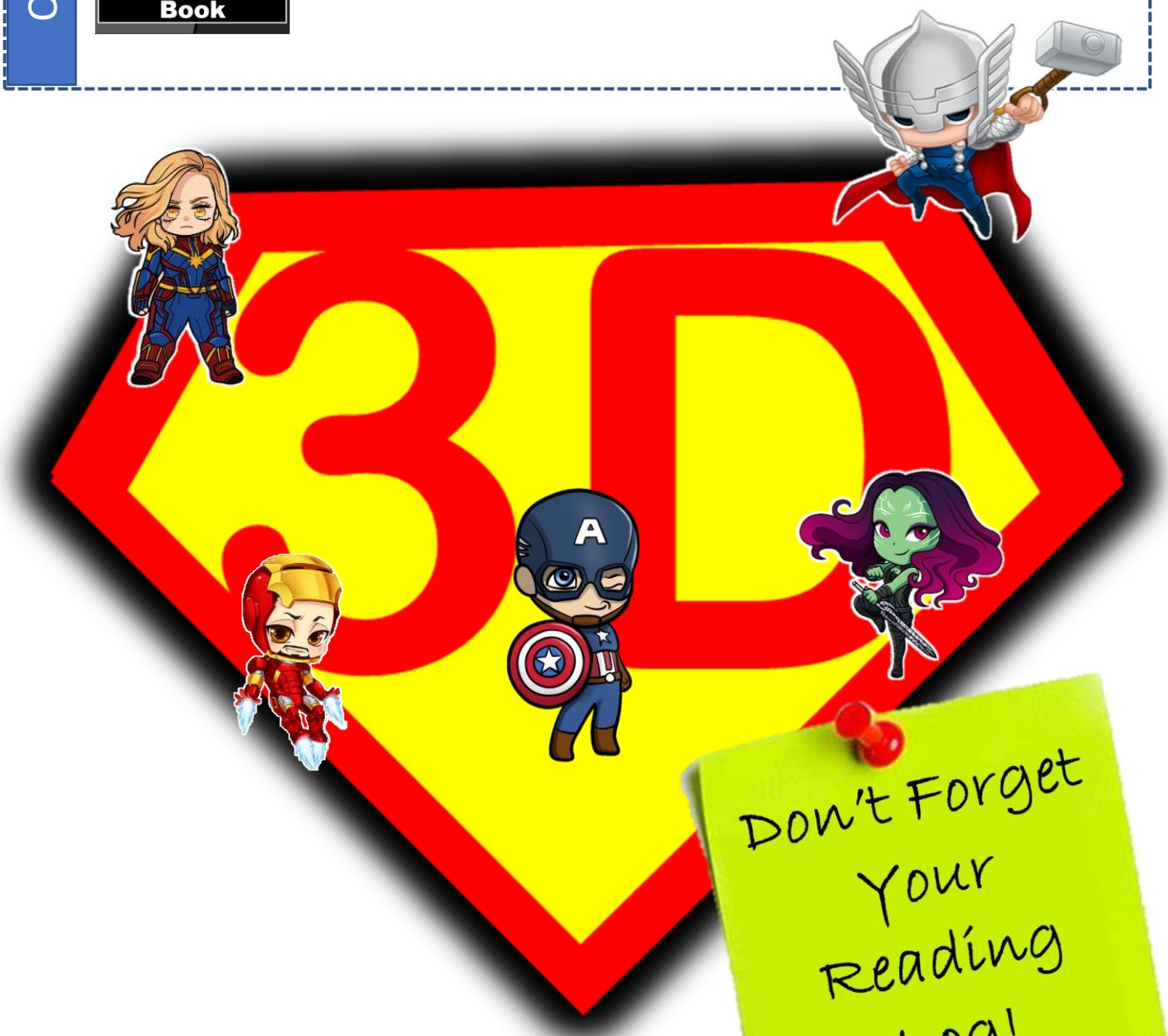

Don't Forget Your Reading Log!

WEEKLY REVIEW: 4~5 (SEPTEMBER 18TH ~27TH)

TUESDAY

NAME:

20 Minute Write

Think of a SMALL MOMENT that you had fun with your friends. Using the PAST TENSE, write what you and your friends did. Use lots of ADJECTIVES and NOUNS.

Quick Maths

Mr. K. collects retro 1990's basketball cards. He makes an array of 4 x 6 of his favourite cards. He adds one more row of cards. Draw this as an array.

3D

JLA TUESDAY JUSTICE LEAGUE

WEEKLY REVIEW: 4~5 (SEPTEMBER 18TH ~27TH)